(1)
a) 7 m (dm)
b) 6 km (m)
c) 5 dm (cm)
d) 560 cm (dm)
e) 940 mm (cm)
f) 7000 m (km)
g) 72 dm (mm)
h) 6300 dm (mm)

(2) Schreibe ohne Komma, in einer kleineren Masseinheit.
a) 4.81 m
b) 6.7 m
c) 4.964 km
d) 5.03 m
e) 0.69 m
f) 0.1 cm
g) 0.05 dm
h) 0.56 km

(3) Schreibe in der in Klammern angegebenen Masseinheit.
a) 34 dm² (cm²)
b) 57 m² (dm²)
c) 7 km² (ha)
d) 16 ha (m²)
e) 39 a (m²)
f) 41 cm² (mm²)
g) 2700 mm² (cm²)
h) 60'000 cm² (m²)

(4) Berechne die Fläche und gib das Resultat in m² an.

a)
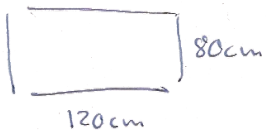


b)
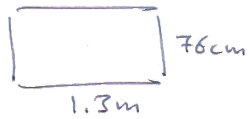


c)
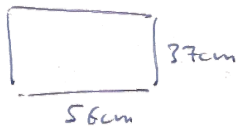


d)
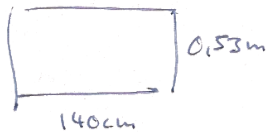


(5) Berechne die Fläche und gib das Resultat dm² an.

a)
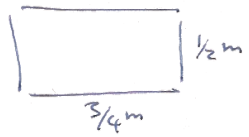


b)
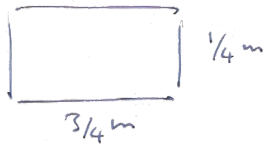


c)
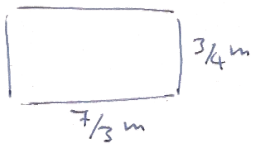

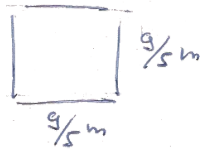
d)